Improper and Mixed Fractions Visual

Name:

Write each amount as a mixed number.

1) 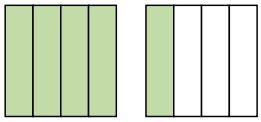

2) 

3) 

4) 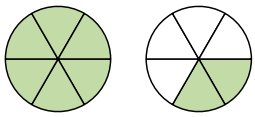

5) 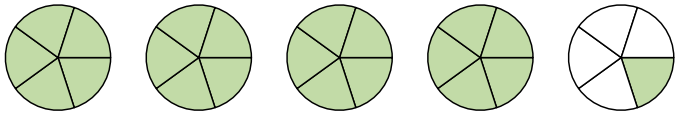

Write each amount as an improper fraction.

6) 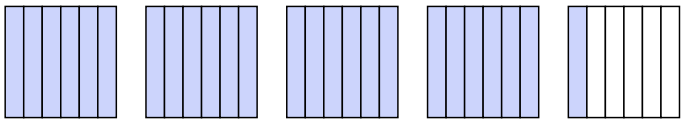

7) 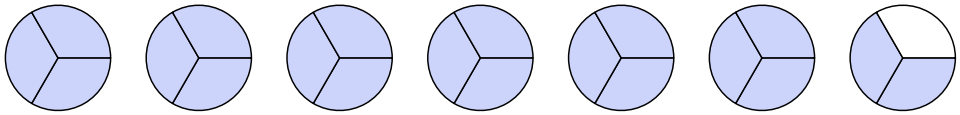

8) 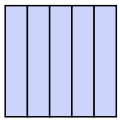

9) 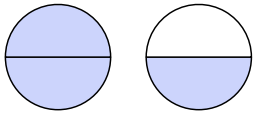

10) 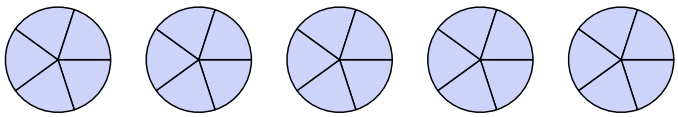

11) 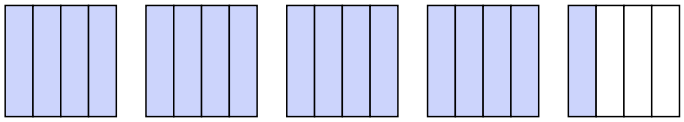

Answers

1. _____
2. _____
3. _____
4. _____
5. _____
6. _____
7. _____
8. _____
9. _____
10. _____
11. _____

1-10	91	82	73	64	55	45	36	27	18	9
11	0									

Improper and Mixed Fractions Visual

Name: **Answer Key**

Write each amount as a mixed number.

1) 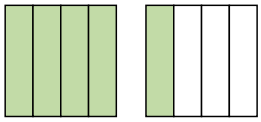

2) 

3) 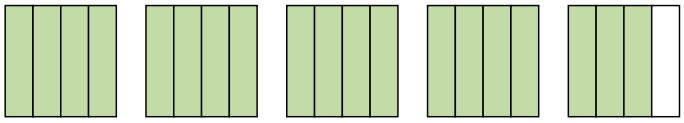

4) 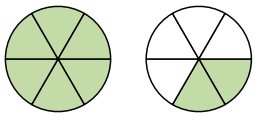

5) 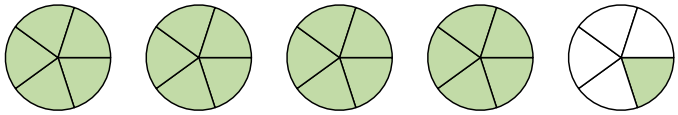

Write each amount as an improper fraction.

6) 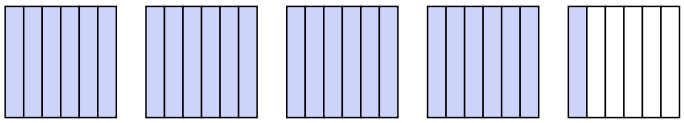

7) 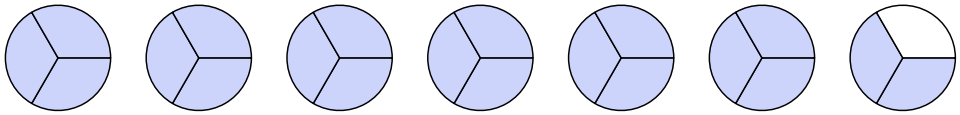

8) 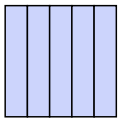

9) 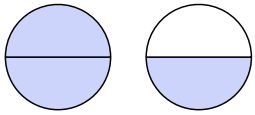

10) 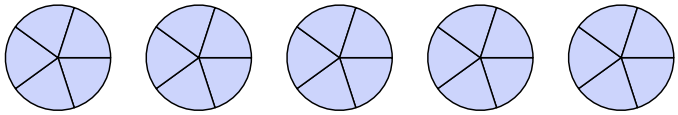

11) 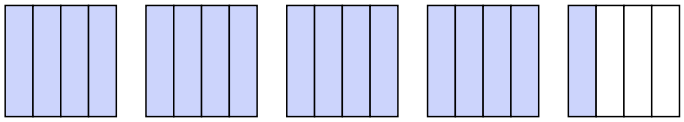

Answers

1. $1\frac{1}{4}$
2. $4\frac{1}{2}$
3. $4\frac{3}{4}$
4. $1\frac{2}{6}$
5. $4\frac{1}{5}$
6. $\frac{25}{6}$
7. $\frac{20}{3}$
8. $\frac{5}{5}$
9. $\frac{3}{2}$
10. $\frac{25}{5}$
11. $\frac{17}{4}$